Name _____ Date _____

Learning Target: I will subtract numbers within 10. 2nd Grade - Readiness Standard 5 - 1.OA.6c - Form A

1. We Do Together: Draw, subtract and write.

Draw 9 circles and cross out 3

Take away to **subtract**	**Write** the missing number
9 – 3 = _____	3 + _____ = 9

2. Reflect: What questions do you have about subtracting numbers within 10?

3. You Do Together: Draw, subtract and write.

Draw 7 circles and cross out 2

Take away to **subtract**	**Write** the missing number
7 – 2 = _____	2 + _____ = 7

Draw 8 circles and cross out 5

Take away to **subtract**	**Write** the missing number
8 – 5 = _____	5 + _____ = 8

© OAISD, April 2019

Name _____ Date _____

Learning Target: I will subtract numbers within 10. 2nd Grade - Readiness Standard 5 - 1.OA.6c - Form B

1. We Do Together: Draw, subtract and write.

Draw 8 circles and cross out 2

Take away to **subtract**	**Write** the missing number
8 – 2 = _____	2 + _____ = 8

2. Reflect: What questions do you have about subtracting numbers within 10?

3. You Do Together: Draw, subtract and write.

Draw 7 circles and cross out 3

Take away to **subtract**	**Write** the missing number
7 – 3 = _____	3 + _____ = 7

Draw 9 circles and cross out 6

Take away to **subtract**	**Write** the missing number
9 – 6 = _____	6 + _____ = 9

© OAISD, April 2019

Name _____ Date _____

Learning Target: I will subtract numbers within 10. 2nd Grade - Readiness Standard 5 - 1.OA.6c - Form C

1. We Do Together: Draw, subtract and write.

Draw 7 circles and cross out 4

Take away to **subtract**	**Write** the missing number
7 – 4 = _____	4 + _____ = 7

2. Reflect: What questions do you have about subtracting numbers within 10?

3. You Do Together: Draw, subtract and write.

Draw 9 circles and cross out 5

Take away to **subtract**	**Write** the missing number
9 – 5 = _____	5 + _____ = 9

Draw 8 circles and cross out 3

Take away to **subtract**	**Write** the missing number
8 – 3 = _____	3 + _____ = 8

© OAISD, April 2019

Name _____ Date _____

Learning Target: I will subtract numbers within 10. 2nd Grade - Readiness Standard 5 - 1.OA.6c - Form A

1. **We Do Together:** Draw, subtract and write.

Draw 9 circles and cross out 3

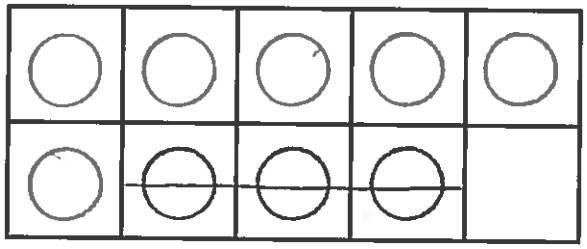

Take away to **subtract**	**Write** the missing number
9 − 3 = 6	3 + 6 = 9

2. **Reflect:** What questions do you have about subtracting numbers within 10?

3. **You Do Together:** Draw, subtract and write.

Draw 7 circles and cross out 2

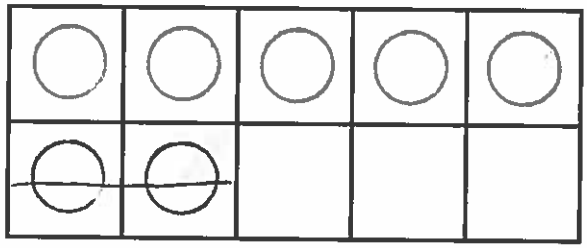

Take away to **subtract**	**Write** the missing number
7 − 2 = 5	2 + 5 = 7

Draw 8 circles and cross out 5

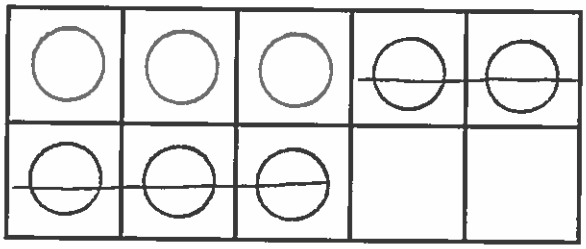

Take away to **subtract**	**Write** the missing number
8 − 5 = 3	5 + 3 = 8

© OAISD, April 2019