1st Grade Summer Guided Review

Readiness Standard 1 - K.CC.5

Name_____ Date_____

Learning Target: I will count up to 20 objects.

1.

Count the dots.



○ 6 ○ 7 ○ 8 ○ 9

2.

Count the dots.



○ 14 ○ 15 ○ 16 ○ 17

3.

Count the dots.



○ 16 ○ 17 ○ 18 ○ 19

© OAISD, June 2014

1st Grade Quick Check – Form A

Readiness Standard 1 - K.CC.5

Name_____ Date_____

Learning Target: I will count up to 20 objects.

Directions: Write how many dots are in each group. (Work time: 3 minutes)

1.



_____

2.



_____

3.



_____

4.



_____

5.



_____

6.



_____

© OAISD, June 2014

1st Grade Quick Check – Form B

Readiness Standard 1 - K.CC.5

Name_____ Date_____

Learning Target: I will count up to 20 objects.

Directions: Write how many dots are in each group. (Work time: 3 minutes)

1.



_____

2.



_____

3.



_____

4.



_____

5.



_____

6.



_____

© OAISD, June 2014

1st Grade Quick Check – Form C

Readiness Standard 1 - K.CC.5

Name_____ Date_____

Learning Target: I will count up to 20 objects.

Directions: Write how many dots are in each group. (Work time: 3 minutes)

1.



_____

2.



_____

3.



_____

4.



_____

5.



_____

6.



_____

© OAISD, June 2014

1st Grade Quick Check – Form D

Readiness Standard 1 - K.CC.5

Name_____ Date_____

Learning Target: I will count up to 20 objects.

Directions: Write how many dots are in each group. (Work time: 3 minutes)

1.



_____

2.



_____

3.



_____

4.



_____

5.



_____

6.



_____

© OAISD, June 2014

1st Grade Growth Chart

Readiness Standard 1 - K.CC.5

Name_____

Learning Target: I will count up to 20 objects.

Goal: 5 out of 6 correct

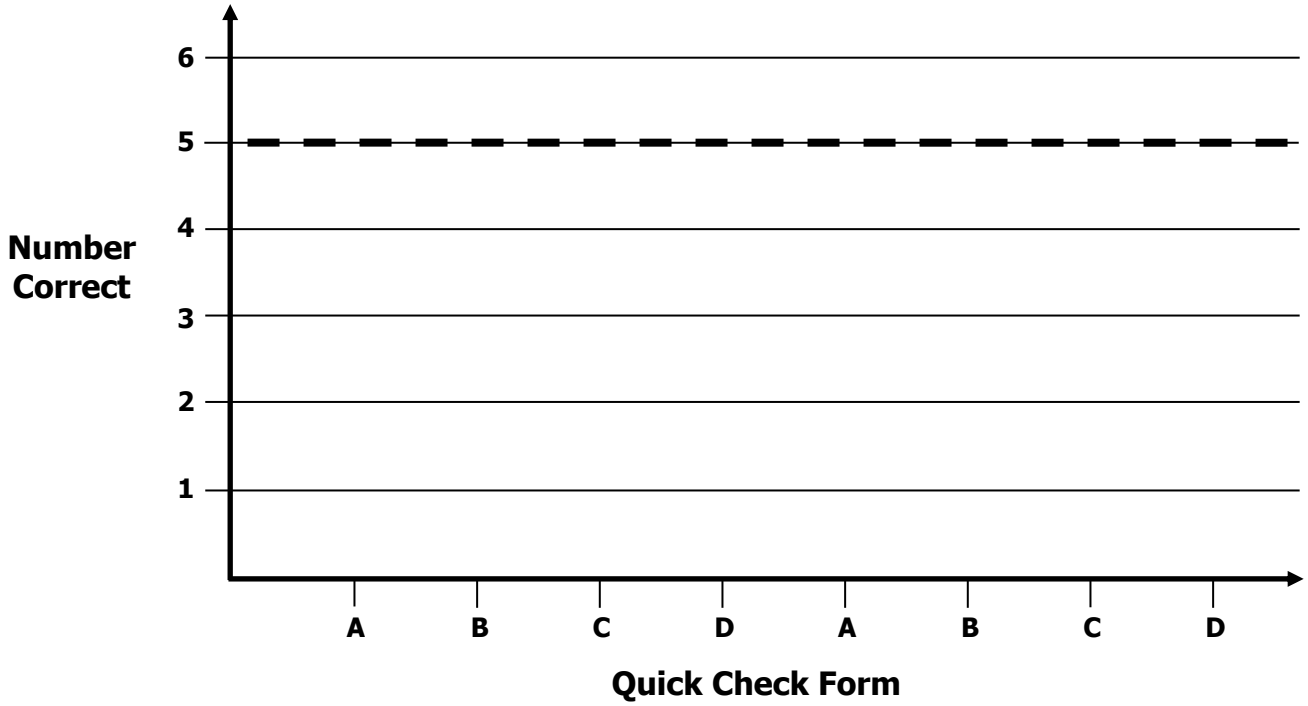

Intervention	Date	Score
Guided Review		

© OAISD, June 2014

1st Grade Summer Guided Review

Readiness Standard 2 - K.CC.7

Name_____ Date_____

Learning Target: I will compare numbers to 10.

1.

Which number is **greater**?

○ 5 ○ 2

2.

Which number is **greater**?

○ 6 ○ 9

3.

Which number is **less**?

○ 4 ○ 9

© OAISD, June 2014

1st Grade Quick Check – Form A

Readiness Standard 2 - K.CC.7

Name_____ Date_____

Learning Target: I will compare numbers to 10.

Directions: Choose the number that is **greater**? (Work time: 1 minute)

1. ○ 2 ○ 5
2. ○ 7 ○ 4
3. ○ 8 ○ 3

Directions: Choose the number that is **less**? (Work time: 1 minute)

4. ○ 4 ○ 9
5. ○ 8 ○ 7
6. ○ 3 ○ 2

© OAISD, June 2014

1st Grade Quick Check – Form B

Readiness Standard 2 - K.CC.7

Name_____ Date_____

Learning Target: I will compare numbers to 10.

Directions: Choose the number that is **greater**? (Work time: 1 minute)

1.	○ 6	○ 4
2.	○ 2	○ 7
3.	○ 5	○ 3

Directions: Choose the number that is **less**? (Work time: 1 minute)

4.	○ 9	○ 6
5.	○ 5	○ 2
6.	○ 3	○ 8

© OAISD, June 2014

1st Grade Quick Check – Form C

Readiness Standard 2 - K.CC.7

Name_____ Date_____

Learning Target: I will compare numbers to 10.

Directions: Choose the number that is **greater**? (Work time: 1 minute)

1.	○ 9 ○ 6
2.	○ 5 ○ 2
3.	○ 3 ○ 8

Directions: Choose the number that is **less**? (Work time: 1 minute)

4.	○ 1 ○ 4
5.	○ 2 ○ 7
6.	○ 5 ○ 3

© OAISD, June 2014

1st Grade Quick Check – Form D

Readiness Standard 2 - K.CC.7

Name_____ Date_____

Learning Target: I will compare numbers to 10.

Directions: Choose the number that is **greater**? (Work time: 1 minute)

1.	○ 4	○ 9
2.	○ 8	○ 7
3.	○ 2	○ 5

Directions: Choose the number that is **less**? (Work time: 1 minute)

4.	○ 3	○ 5
5.	○ 7	○ 4
6.	○ 9	○ 6

© OAISD, June 2014

1st Grade Growth Chart

Readiness Standard 2 - K.CC.7

Name_____

Learning Target: I will compare numbers to 10.

Goal: 5 out of 6 correct

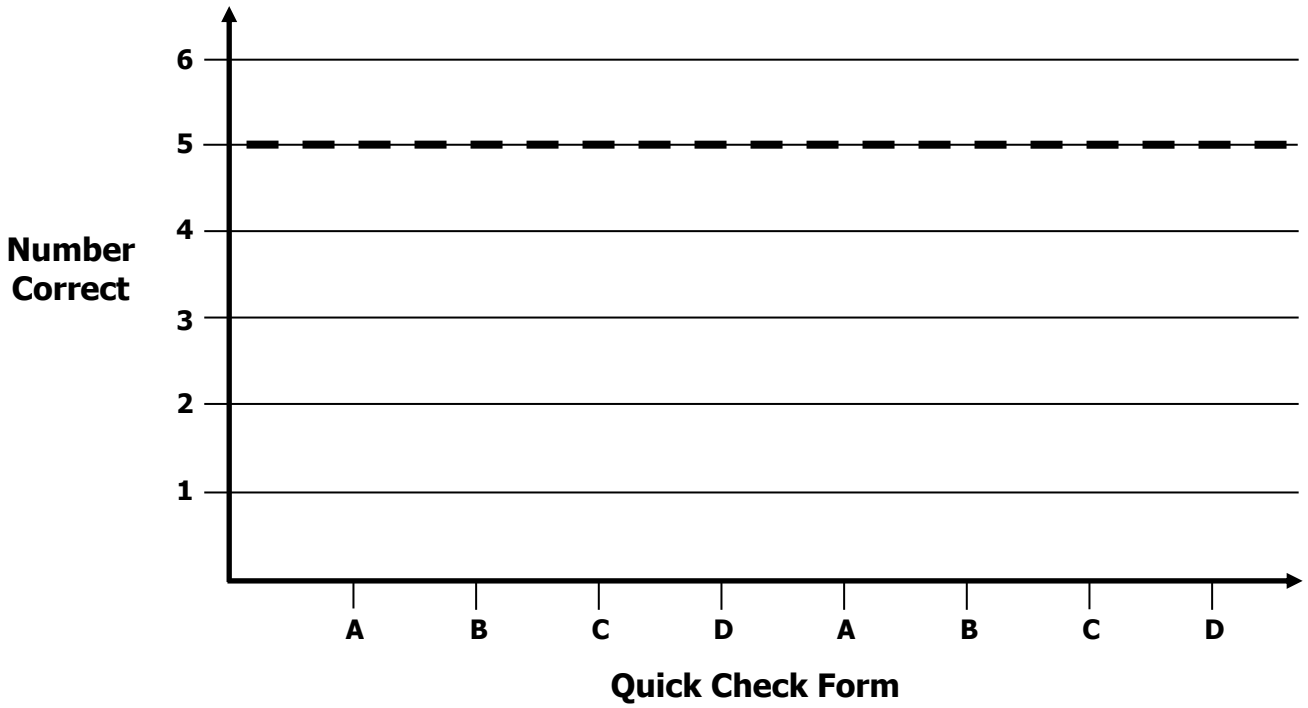

Intervention	Date	Score
Guided Review		

© OAISD, June 2014

1st Grade Summer Guided Review

Readiness Standard 3 - K.NBT.1

Name_____ Date_____

Learning Target: I will name numbers to 19 using ten ones and some more ones.

1.

Which number is shown by the dots?

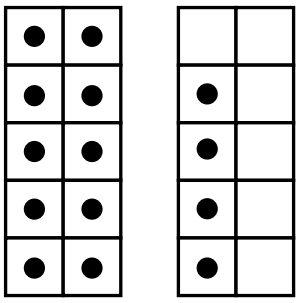

○ 4 ○ 14 ○ 9 ○ 10

2.

Which number is shown by the dots?



○ 18 ○ 81 ○ 19 ○ 91

3.

Which number is shown by the dots?

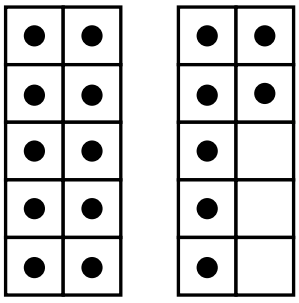

○ 71 ○ 61 ○ 17 ○ 16

© OAISD, June 2014

1st Grade Quick Check – Form A

Readiness Standard 3 - K.NBT.1

Name_____ Date_____

Learning Target: I will name numbers to 19 using ten ones and some more ones.

Directions: Write how many dots are in each group. (Work time: 3 minutes)

1.



_____

2.

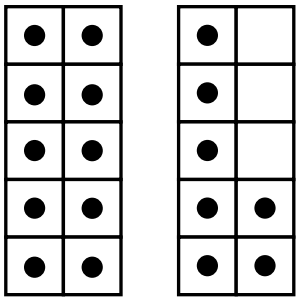

_____

3.

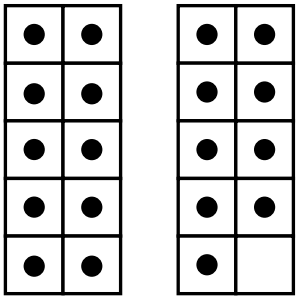

_____

4.



_____

5.



_____

6.

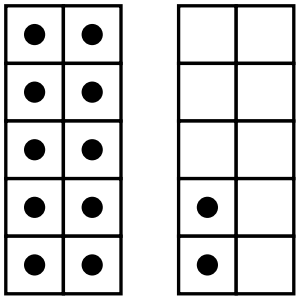

_____

© OAISD, June 2014

1st Grade Quick Check – Form B

Readiness Standard 3 - K.NBT.1

Name_____ Date_____

Learning Target: I will name numbers to 19 using ten ones and some more ones.

Directions: Write how many dots are in each group. (Work time: 3 minutes)

1.



_____

2.

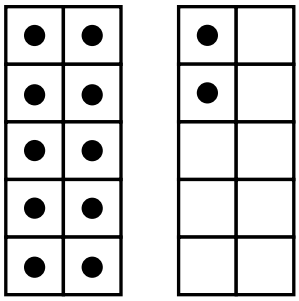

_____

3.

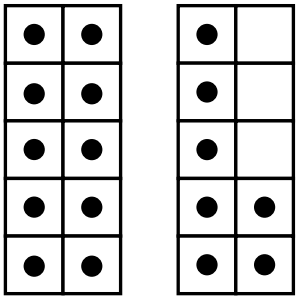

_____

4.



_____

5.



_____

6.

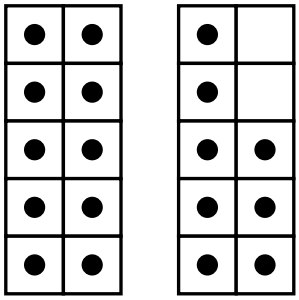

_____

© OAISD, June 2014

1st Grade Quick Check – Form C

Readiness Standard 3 - K.NBT.1

Name_____ Date_____

Learning Target: I will name numbers to 19 using ten ones and some more ones.

Directions: Write how many dots are in each group. (Work time: 3 minutes)

1.



_____

2.

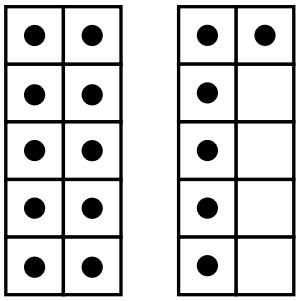

_____

3.

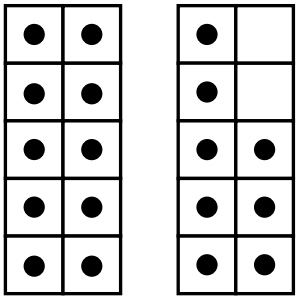

_____

4.



_____

5.



_____

6.



_____

© OAISD, June 2014

1st Grade Quick Check – Form D

Readiness Standard 3 - K.NBT.1

Name_____ Date_____

Learning Target: I will name numbers to 19 using ten ones and some more ones.

Directions: Write how many dots are in each group. (Work time: 3 minutes)

1.



_____

2.

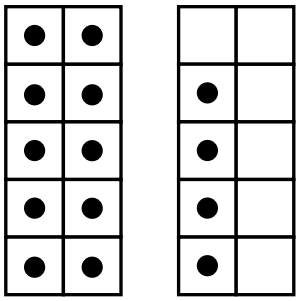

_____

3.

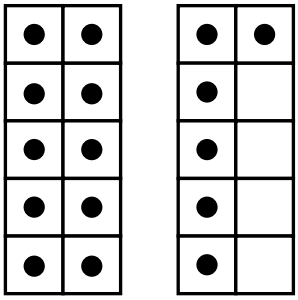

_____

4.



_____

5.



_____

6.

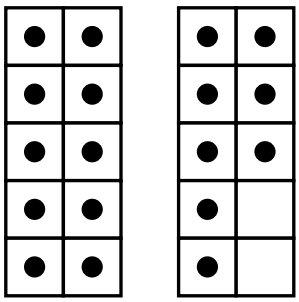

_____

© OAISD, June 2014

1st Grade Growth Chart

Readiness Standard 3 - K.NBT.1

Name_____

Learning Target: I will name numbers to 19 using ten ones and some more ones.

Goal: 5 out of 6 correct

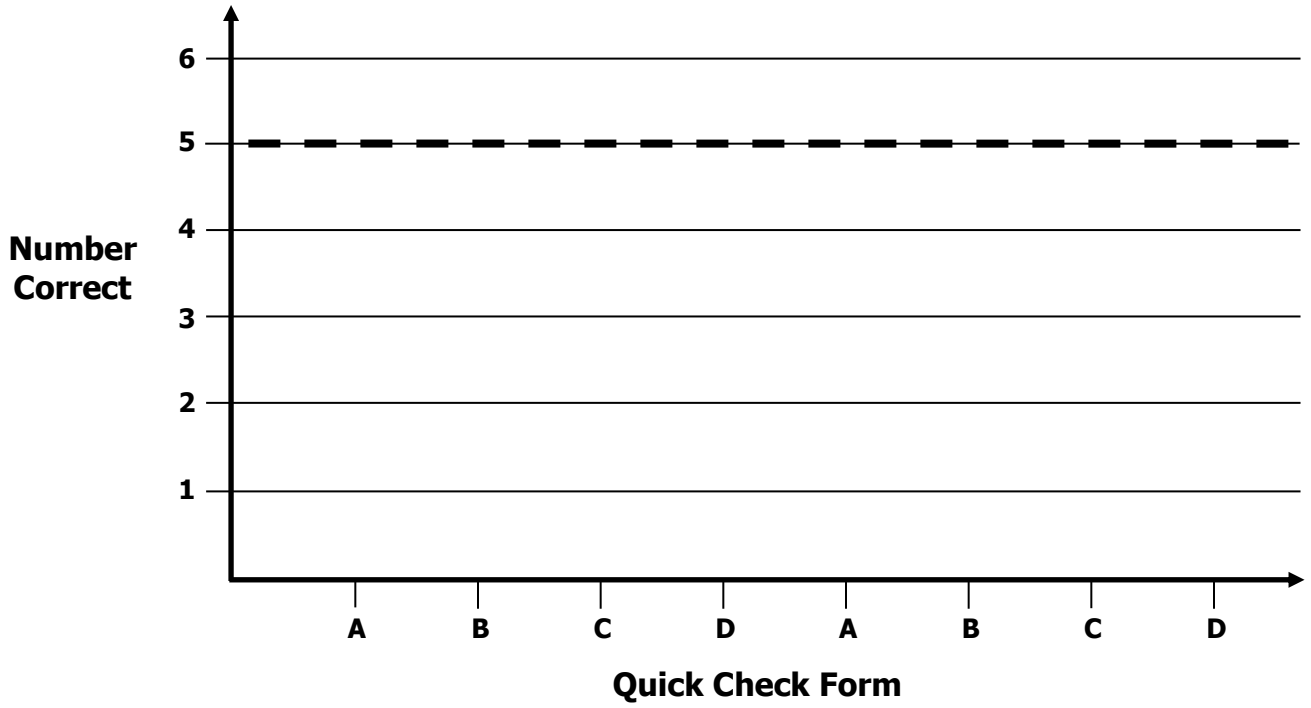

Intervention	Date	Score
Guided Review		

© OAISD, June 2014

1st Grade Summer Guided Review

Readiness Standard 4 - K.OA.4

Name_____ Date_____

Learning Target: I will find numbers that add to make 10.

1.

$$6 + ___ = 10$$

○ 4 ○ 5 ○ 6 ○ 7

2.

$$7 + ___ = 10$$

○ 5 ○ 4 ○ 3 ○ 2

3.

$$2 + ___ = 10$$

○ 6 ○ 8 ○ 7 ○ 9

© OAISD, June 2014

1st Grade Quick Check – Form A

Readiness Standard 4 - K.OA.4

Name_____ Date_____

Learning Target: I will find numbers that add to make 10.

Directions: Fill in the blank. (Work time: 3 minutes)

1. 8 + ____ = 10	**2.** 6 + ____ = 10
3. 5 + ____ = 10	**4.** 1 + ____ = 10
5. 3 + ____ = 10	**6.** 7 + ____ = 10

© OAISD, June 2014

1st Grade Quick Check – Form B

Readiness Standard 4 - K.OA.4

Name_____ Date_____

Learning Target: I will find numbers that add to make 10.

Directions: Fill in the blank. (Work time: 3 minutes)

1. 7 + ____ = 10	**2.** 4 + ____ = 10
3. 9 + ____ = 10	**4.** 2 + ____ = 10
5. 5 + ____ = 10	**6.** 6 + ____ = 10

© OAISD, June 2014

1st Grade Quick Check – Form C

Readiness Standard 4 - K.OA.4

Name_____ Date_____

Learning Target: I will find numbers that add to make 10.

Directions: Fill in the blank. (Work time: 3 minutes)

1. 9 + ____ = 10	**2.** 3 + ____ = 10
3. 6 + ____ = 10	**4.** 8 + ____ = 10
5. 4 + ____ = 10	**6.** 7 + ____ = 10

© OAISD, June 2014

1st Grade Quick Check – Form D

Readiness Standard 4 - K.OA.4

Name_____ Date_____

Learning Target: I will find numbers that add to make 10.

Directions: Fill in the blank. (Work time: 3 minutes)

1. 6 + ____ = 10	**2.** 7 + ____ = 10
3. 8 + ____ = 10	**4.** 3 + ____ = 10
5. 1 + ____ = 10	**6.** 5 + ____ = 10

© OAISD, June 2014

1st Grade Growth Chart

Readiness Standard 4 - K.OA.4

Name_____

Learning Target: I will find numbers that add to make 10.

Goal: 5 out of 6 correct

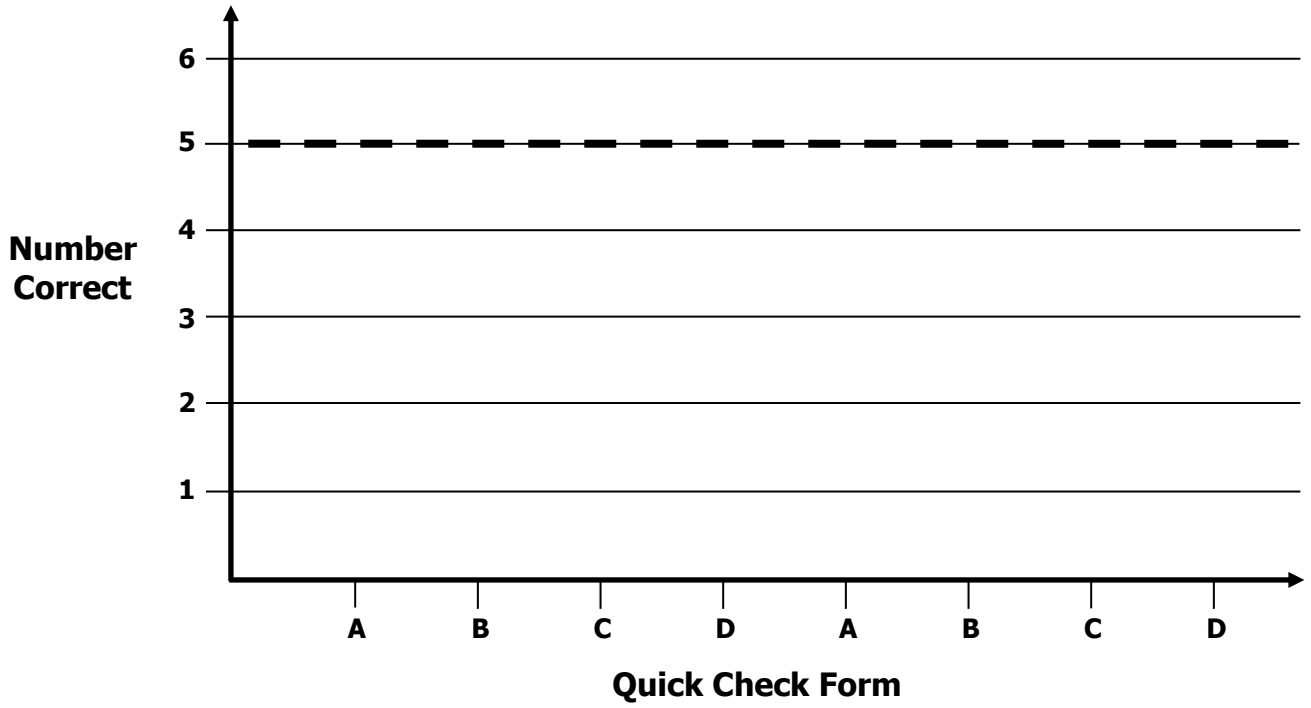

Intervention	Date	Score
Guided Review		

© OAISD, June 2014

1st Grade Summer Guided Review

Readiness Standard 5 - K.OA.5a

Name_____ Date_____

Learning Target: I will add numbers to 5.

4 + 1 = ____	3 + 1 = ____
1 + 3 = ____	2 + 0 = ____
2 + 2 = ____	1 + 2 = ____
3 + 2 = ____	0 + 3 = ____
0 + 4 = ____	1 + 4 = ____
1 + 1 = ____	2 + 3 = ____

© OAISD, June 2014

1st Grade Quick Check – Form A

Readiness Standard 5 - K.OA.5a

Name_____ Date_____

Learning Target: I will add numbers to 5.

Directions: When you are told to begin, answer as many addition problems as you can.
(Work Time: 1 minute)

4 + 1 = ____	3 + 1 = ____
1 + 3 = ____	2 + 0 = ____
2 + 2 = ____	1 + 2 = ____
3 + 2 = ____	0 + 3 = ____
0 + 4 = ____	1 + 4 = ____
1 + 1 = ____	2 + 3 = ____

Number Correct = _____

© OAISD, June 2014

1st Grade Quick Check – Form B

Readiness Standard 5 - K.OA.5a

Name_____ Date_____

Learning Target: I will add numbers to 5.

Directions: When you are told to begin, answer as many addition problems as you can.
(Work Time: 1 minute)

2 + 0 = ____	3 + 2 = ____
1 + 3 = ____	4 + 1 = ____
1 + 1 = ____	1 + 4 = ____
3 + 1 = ____	0 + 3 = ____
0 + 4 = ____	1 + 2 = ____
2 + 2 = ____	2 + 3 = ____

Number Correct = _____

© OAISD, June 2014

1st Grade Quick Check – Form C

Readiness Standard 5 - K.OA.5a

Name_____ Date_____

Learning Target: I will add numbers to 5.

Directions: When you are told to begin, answer as many addition problems as you can.
(Work Time: 1 minute)

3 + 0 = ____	4 + 1 = ____
1 + 3 = ____	2 + 2 = ____
1 + 1 = ____	1 + 4 = ____
3 + 2 = ____	0 + 2 = ____
0 + 4 = ____	2 + 1 = ____
3 + 2 = ____	1 + 3 = ____

Number Correct = _____

© OAISD, June 2014

1st Grade Quick Check – Form D

Readiness Standard 5 - K.OA.5a

Name_____ Date_____

Learning Target: I will add numbers to 5.

Directions: When you are told to begin, answer as many addition problems as you can.
(Work Time: 1 minute)

1 + 1 = ____	3 + 1 = ____
2 + 3 = ____	2 + 0 = ____
2 + 2 = ____	1 + 4 = ____
3 + 2 = ____	0 + 3 = ____
0 + 4 = ____	1 + 2 = ____
4 + 1 = ____	1 + 3 = ____

Number Correct = _____

© OAISD, June 2014

1st Grade Growth Chart

Readiness Standard 5 - K.OA.5a

Name_____

Learning Target: I will add numbers to 5.

Goal: 10 out of 12 correct

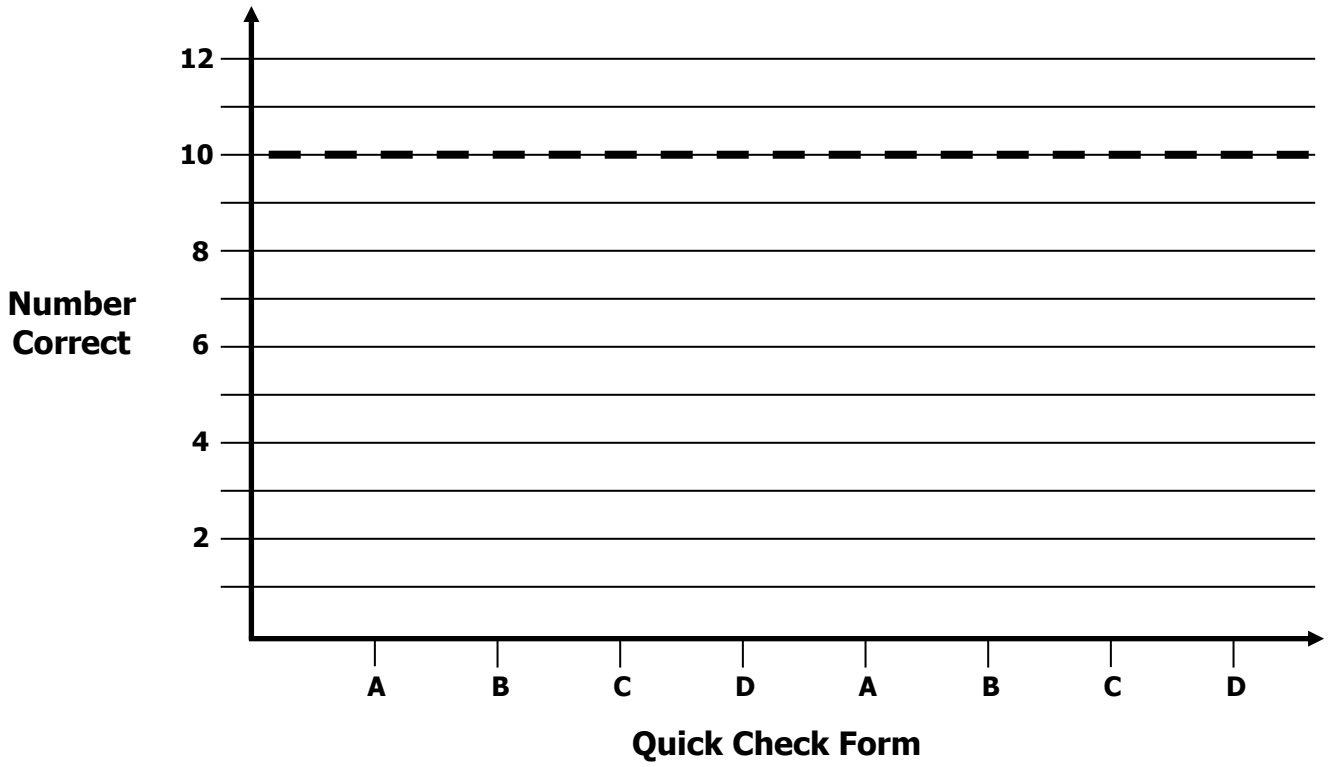

Intervention	Date	Score
Guided Review		

© OAISD, June 2014

1st Grade Summer Guided Review

Readiness Standard 6 - K.OA.5b

Name_____ Date_____

Learning Target: I will subtract numbers within 5.

4 – 2 = ____	5 – 1 = ____
2 – 1 = ____	3 – 1 = ____
5 – 2 = ____	4 – 3 = ____
2 – 0 = ____	5 – 4 = ____
4 – 1 = ____	3 – 2 = ____
5 – 3 = ____	4 – 0 = ____

© OAISD, June 2014

1st Grade Quick Check – Form A

Readiness Standard 6 - K.OA.5b

Name_____ Date_____

Learning Target: I will subtract numbers within 5.

Directions: When you are told to begin, answer as many subtraction problems as you can.
(Work Time: 1 minute)

5 – 3 = ____	4 – 0 = ____
4 – 1 = ____	3 – 2 = ____
2 – 0 = ____	5 – 4 = ____
5 – 2 = ____	4 – 3 = ____
2 – 1 = ____	3 – 1 = ____
4 – 2 = ____	5 – 1 = ____

Number Correct = _____

© OAISD, June 2014

1st Grade Quick Check – Form B

Readiness Standard 6 - K.OA.5b

Name_____ Date_____

Learning Target: I will subtract numbers within 5.

Directions: When you are told to begin, answer as many subtraction problems as you can.
(Work Time: 1 minute)

5 – 2 = ____	4 – 3 = ____
2 – 0 = ____	5 – 4 = ____
4 – 1 = ____	3 – 2 = ____
5 – 3 = ____	4 – 0 = ____
4 – 2 = ____	5 – 1 = ____
2 – 1 = ____	3 – 1 = ____

Number Correct = _____

© OAISD, June 2014

1st Grade Quick Check – Form C

Readiness Standard 6 - K.OA.5b

Name_____ Date_____

Learning Target: I will subtract numbers within 5.

Directions: When you are told to begin, answer as many subtraction problems as you can.
(Work Time: 1 minute)

5 – 1 = ____	4 – 2 = ____
3 – 1 = ____	2 – 1 = ____
4 – 3 = ____	5 – 2 = ____
5 – 4 = ____	2 – 0 = ____
3 – 2 = ____	4 – 1 = ____
4 – 0 = ____	5 – 3 = ____

Number Correct = _____

© OAISD, June 2014

1st Grade Quick Check – Form D

Readiness Standard 6 - K.OA.5b

Name_____ Date_____

Learning Target: I will subtract numbers within 5.

Directions: When you are told to begin, answer as many subtraction problems as you can.
(Work Time: 1 minute)

3 – 2 = ____	4 – 1 = ____
4 – 0 = ____	5 – 3 = ____
5 – 1 = ____	4 – 2 = ____
3 – 1 = ____	2 – 1 = ____
4 – 3 = ____	5 – 2 = ____
5 – 4 = ____	2 – 0 = ____

Number Correct = _____

© OAISD, June 2014

1st Grade Growth Chart

Readiness Standard 6 - K.OA.5b

Name_____

Learning Target: I will subtract numbers within 5.

Goal: 10 out of 12 correct



Intervention	Date	Score
Guided Review		

© OAISD, June 2014